On souhaite placer des points sur les *nœuds* d'un quadrillage comme celui-ci, sans que trois de ces points soient alignés.

Combien peut-on placer de points *au maximum* en respectant cette consigne ?



Voici plusieurs grilles pour ta recherche.